3 How many stars in the arrays?

a) 

□ + □ + □ = □

There are □ stars.

b)

□ + □ + □ + □ = □

There are □ stars.

4 Tim and Kat are making arrays.

Who has made a mistake?

Tim 

Kat

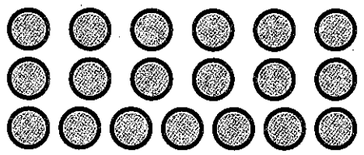



_____ has made a mistake.

CHALLENGE

5 Draw 4 more ● to complete the array.



How many ● are in the array? □

Reflect

I think I can do this in two ways.

Write an addition for this array.